Cognome.....data.....cl.2^C

CALCOLIAMO

1.CALCOLA AIUTANDOTI CON LE DITA.

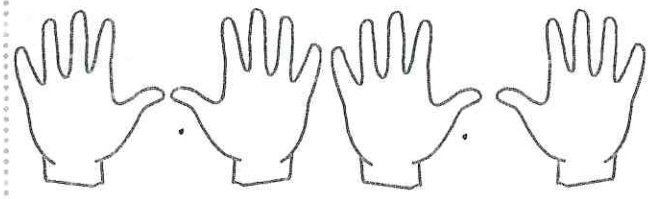

6 + 5 = ...

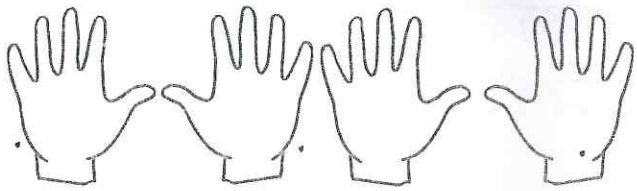

8 + 6 = ...

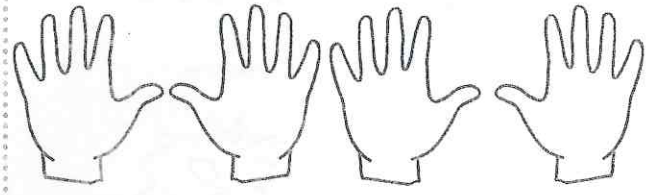

10 + 8 = ...

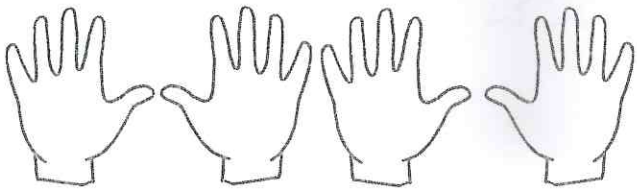

12 + 3 = ...

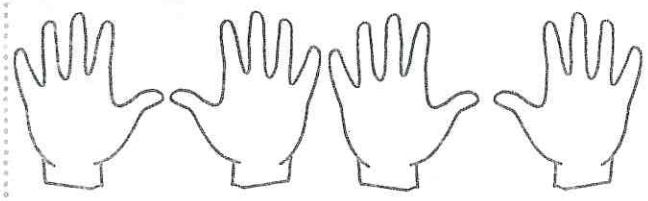

9 + 4 = ...

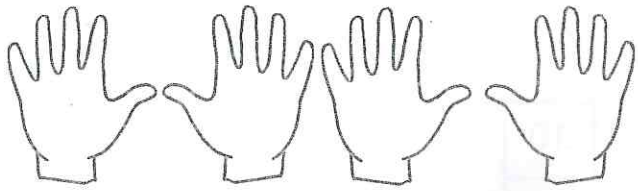

10 + 10 = ...

2.ESEGUI LE SEGUENTI ADDIZIONI.

12 + 6 = ...	11 + 6 = ...	16 + 0 = ...	4 + 6 = ...
16 + 3 = ...	10 + 9 = ...	10 + 2 = ...	5 + 10 = ...
4 + 10 = ...	7+ 8 = ...	6 + 8 = ...	0 + 20 = ...
18 + 2 = ...	15 + 1 = ...	5 + 7 = ...	13 + 5 = ...
9 + 9 = ...	14 + 5 = ...	1 + 12 = ...	7 + 4 = ...

Completa le catene numeriche.

7 $\xrightarrow{+4}$ [ ] $\xrightarrow{-2}$ [ ] $\xrightarrow{+6}$ [ ] $\xrightarrow{-10}$ [ ] $\xrightarrow{+8}$ [13]

19 $\xrightarrow{-9}$ [ ] $\xrightarrow{+7}$ [ ] $\xrightarrow{-0}$ [ ] $\xrightarrow{+3}$ [ ] $\xrightarrow{-5}$ [15]

1.CALCOLA AIUTANDOTI CON LE STELLINE.

15 - 3 = ...

14 - 6 = ...

19 - 4 = ...

20 - 10 = ...

18 - 5 = ...

11 - 7 = ...

2.TROVA IL RISULTATO.

- 3	
10	
8	
13	
4	
17	
9	
20	
16	
3	
6	

- 6	
9	
7	
12	
16	
11	
6	
18	
20	
15	
13	

3.COMPLETA LE TABELLE.

-	1	3	5
9			
6			
7			

-	2	4	6
6			
8			
10			

-	5	10	2
12			
15			
20			

-	3	1	8
13			
11			
16			